Nome : _____ Data : _____

PAPILUMO / 1.º ano (6–7 anos) • Soluções

Adições na reta numérica até 20

Parte do ponto preto, desenha os saltos para a direita e escreve a soma na caixa.



«Coax! Eu sou o Bibi, o sapinho saltitão. Ajuda-me a saltar para a direita até ao resultado certo!»

Exemplo resolvido: 8 + 5 = 13 (parte do 8 e dá 5 saltos para a direita)

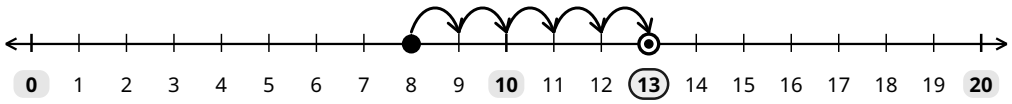

1. Desenha os saltos a partir do ponto preto e escreve cada soma

1 **7 + 6 = 13**

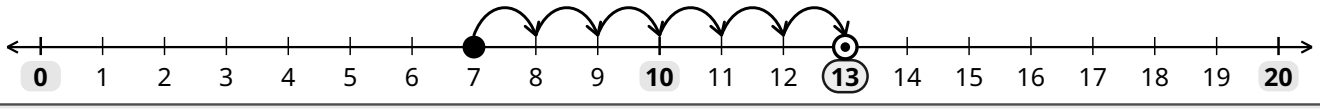

2 **9 + 5 = 14**

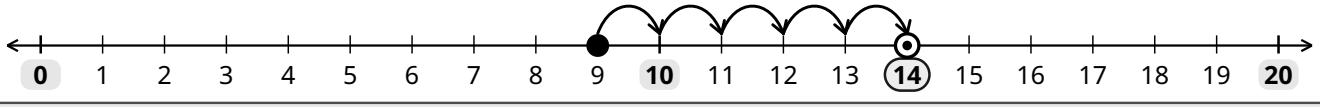

3 **6 + 8 = 14**

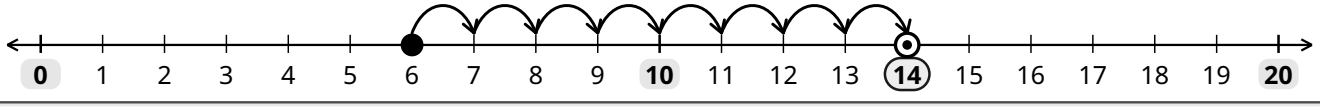

4 **11 + 7 = 18**

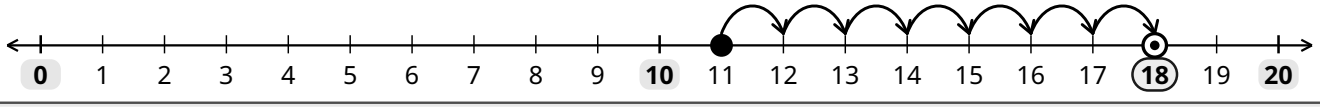

5 **8 + 9 = 17**

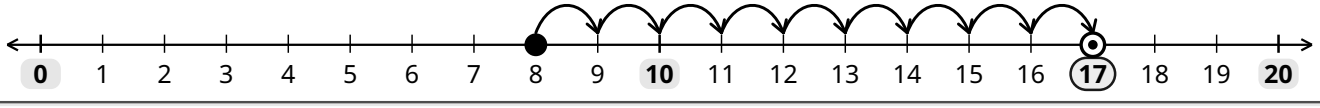

6 **12 + 6 = 18**

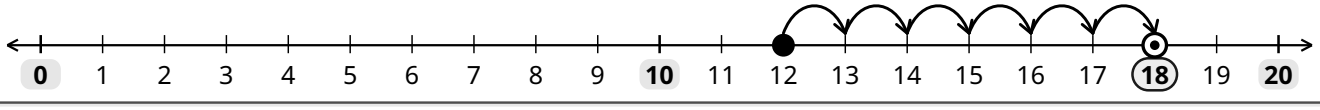

- Dica do Bibi: o ponto preto mostra a partida; conta cada salto só quando aterras no traço seguinte para a direita.