Nome : _____ Data : _____

PAPILUMO / Classe prima (6–7 anni)

Sottrazioni sulla linea dei numeri fino a 20

Parti dal primo numero, disegna ogni salto all'indietro e scrivi la differenza.



Kiko il canguro saltella all'indietro sul sentiero! Conta con lui ogni salto verso sinistra fino al traguardo.

Esempio: 14 − 6 = 8 (parti da 14 e torna indietro di 6 salti)

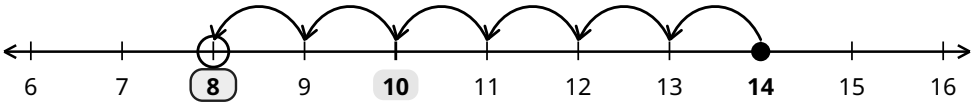

- Non contare il 14 come salto: conta 1 quando atterri sulla tacca del 13.

1 **15 − 7 =** ☐

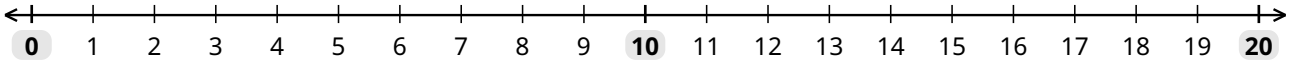

2 **18 − 9 =** ☐

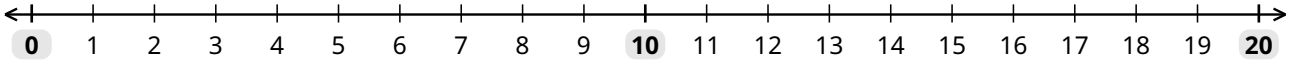

3 **16 − 8 =** ☐

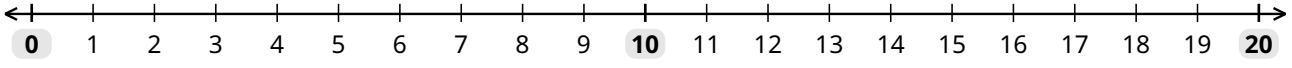

4 **19 − 6 =** ☐

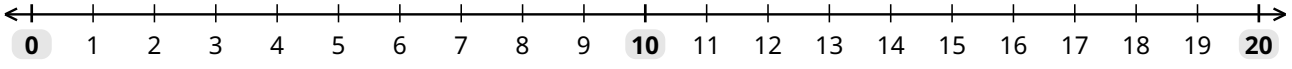

5 **13 − 5 =** ☐

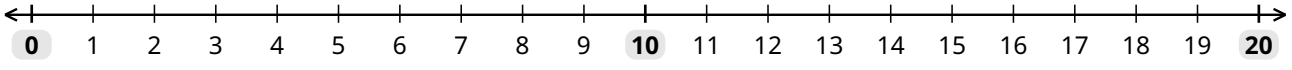

6 **20 − 7 =** ☐

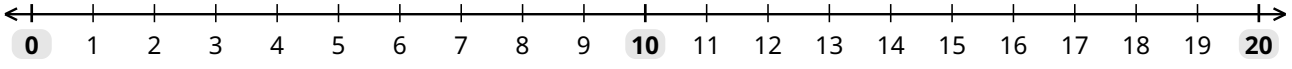

- Consiglio di Kiko: unisci con un arco preciso due tacche vicine, senza saltare mai nessun numero.