Nome : _____ Data : _____

PAPILUMO / Classe prima (6–7 anni)

Addizioni sulla linea dei numeri fino a 20

Parti dal punto nero, disegna i salti verso destra e scrivi la somma nel riquadro.



«Cra! Sono Bibi la rana salterina. Aiutami a fare i salti verso destra fino al risultato giusto!»

Esempio svolto: 8 + 5 = 13 (parti da 8 e fai 5 salti verso destra)

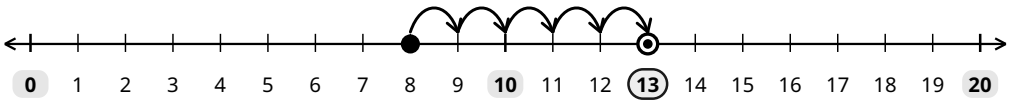

1. Disegna i salti dal punto nero e scrivi ogni somma

1 **7 + 6 =** ☐

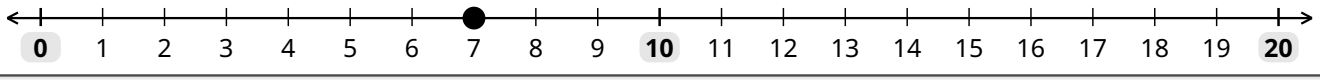

2 **9 + 5 =** ☐

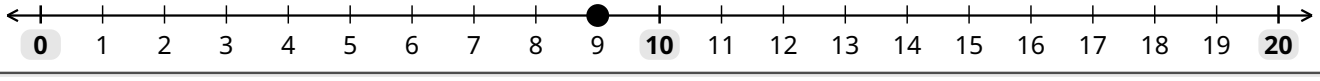

3 **6 + 8 =** ☐

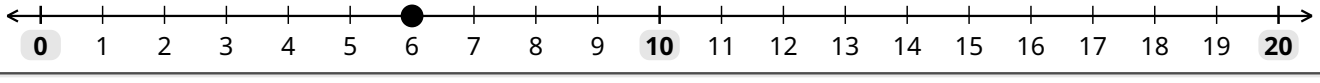

4 **11 + 7 =** ☐

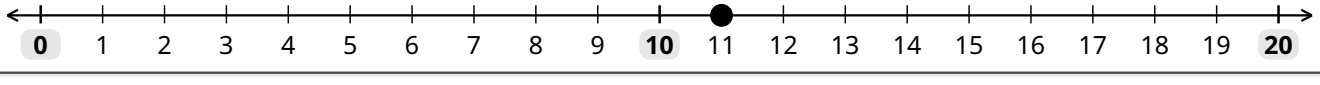

5 **8 + 9 =** ☐

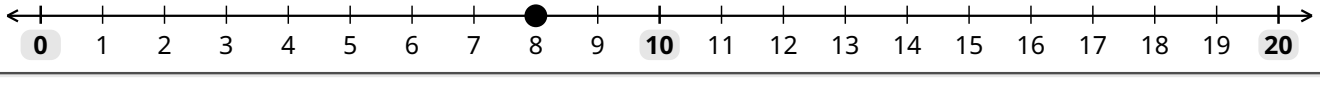

6 **12 + 6 =** ☐

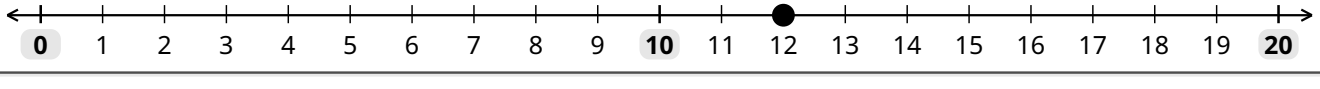

- Consiglio di Bibi: il punto nero indica la partenza; conta ogni salto quando arrivi alla tacca successiva verso destra.