Nome : _____ Data : _____

PAPILUMO / Classe prima (6–7 anni) • Soluzioni

Addizioni sulla linea dei numeri fino a 20

Parti dal punto nero, disegna i salti verso destra e scrivi la somma nel riquadro.



«Cra! Sono Bibi la rana salterina. Aiutami a fare i salti verso destra fino al risultato giusto!»

Esempio svolto: 8 + 5 = 13 (parti da 8 e fai 5 salti verso destra)

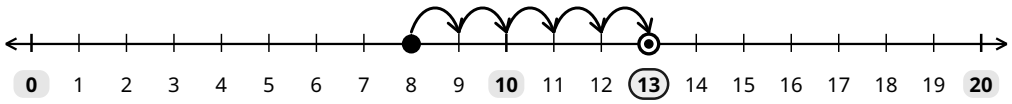

1. Disegna i salti dal punto nero e scrivi ogni somma

1 **7 + 6 = 13**

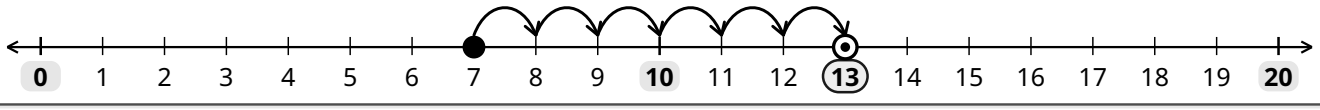

2 **9 + 5 = 14**

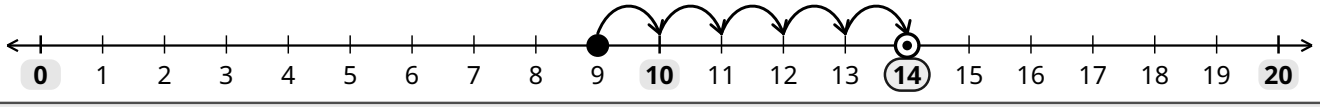

3 **6 + 8 = 14**

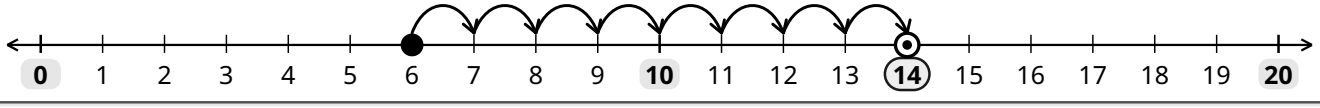

4 **11 + 7 = 18**

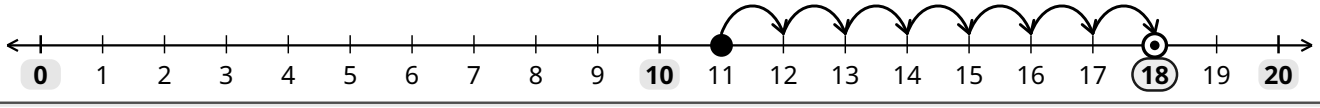

5 **8 + 9 = 17**

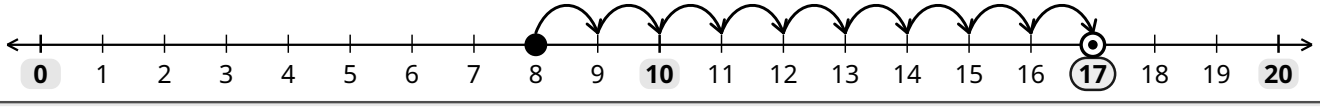

6 **12 + 6 = 18**

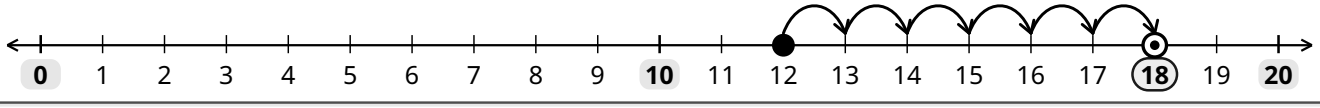

- Consiglio di Bibi: il punto nero indica la partenza; conta ogni salto quando arrivi alla tacca successiva verso destra.