Name : _____ Date : _____

PAPILUMO | 4th Grade

Area & Perimeter of L-Shapes

Draw a dashed split line to cut each L-shape into 2 rectangles, find missing side '?' on C and D, then calculate Area (cm²) and Perimeter (cm).



Gaspard the Architect Giraffe designs L-shaped rooms! Split each shape into two rectangles, then add both rectangle areas and walk all six outer edges.

Example: split, find ?, add

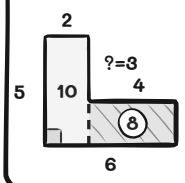

? = 5 − 2 = 3 cm

Area: 10 + 8 = 18 cm²

Perimeter: 22 cm

(5+2+3+4+2+6)

A

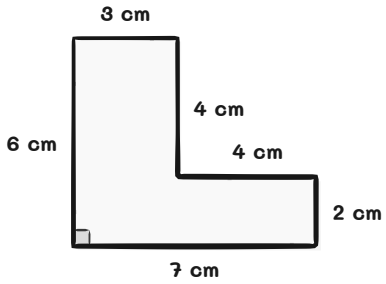

Area: ____ + ____ = _____ cm²

Perimeter: _____ cm

B

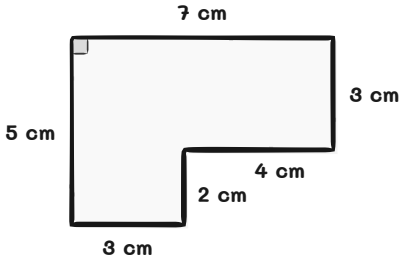

Area: ____ + ____ = _____ cm²

Perimeter: _____ cm

C

Side ? = ____ cm

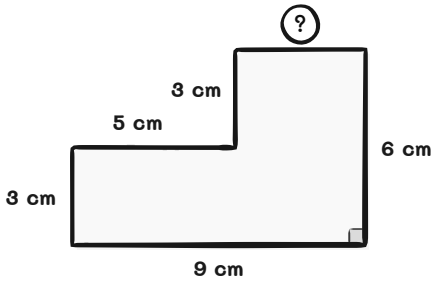

Area: ____ + ____ = _____ cm²

Perimeter: _____ cm

D

Side ? = ____ cm

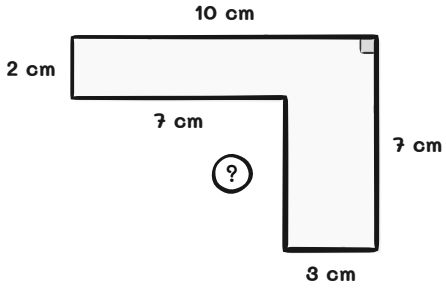

Area: ____ + ____ = _____ cm²

Perimeter: _____ cm

Draw the dashed split line to calculate Area—never include that inside cut when adding up the outer Perimeter!