Name : _____ Date : _____

PAPILUMO | Kindergarten (ages 5–6)

Teen Numbers 11 to 19 (Double Ten Frames)

Study Coco's example, complete 10 + _ = __ for each double ten frame, then draw the extra dots for 17 and 19.



Hi, I'm Coco the counting bunny! One full frame always makes 10—count the extra dots to build each teen number!

Worked example: 1 full ten frame (10) + 4 more dots = 14

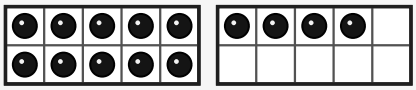

10 + 4 = 14

1. Count the dots in both ten frames and finish each equation

1

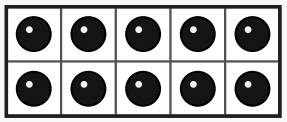

10 + ____ = ____

2

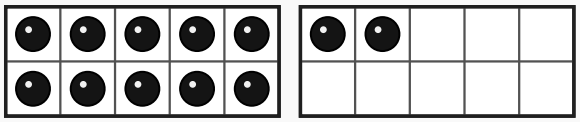

10 + ____ = ____

3

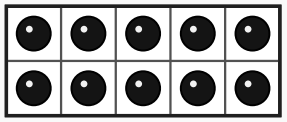

10 + ____ = ____

4

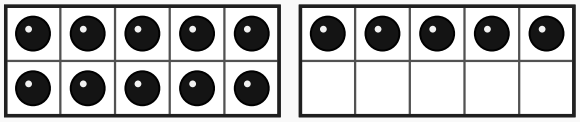

10 + ____ = ____

2. Draw the extra dots in the second frame and write the full equation

5 **Number : 17**

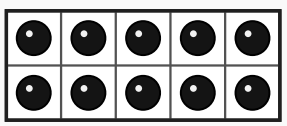

10 + ____ = ____

6 **Number : 19**

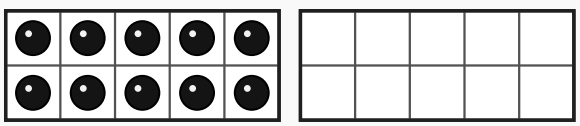

10 + ____ = ____

Coco's tip: do not recount the full ten frame from 1—start at 10 and count on through the extra dots in the second frame.