Name : _____ Date : _____

PAPILUMO / 1st Grade (ages 6–7) • Answer key

Number Line Subtraction Within 20

Start at the first number, draw each backward hop, and write the difference.



Kiko the jumping kangaroo hops backward along his trail! Count every hop left to land on the answer.

Worked example: 14 − 6 = 8 (start at 14, hop back 6)

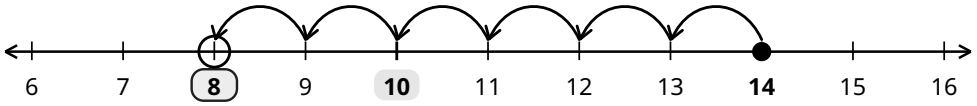

- Do not count 14 as a hop: say 1 on the first arc landing at 13.

1 **15 − 7 =** **8**

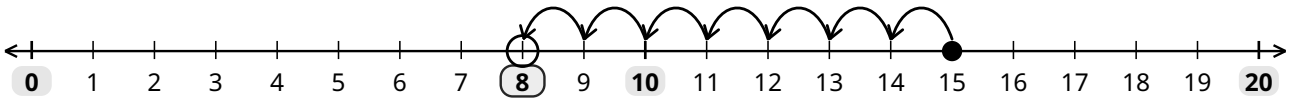

2 **18 − 9 =** **9**

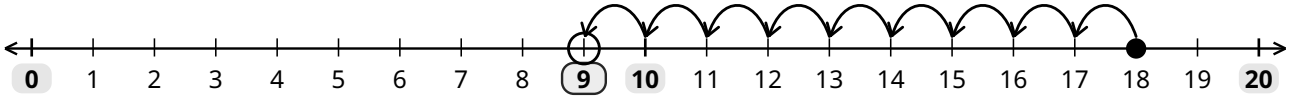

3 **16 − 8 =** **8**

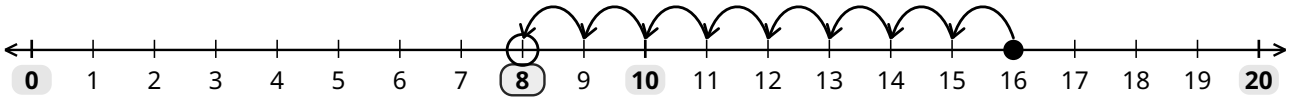

4 **19 − 6 =** **13**

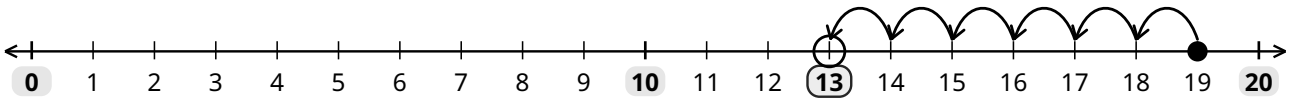

5 **13 − 5 =** **8**

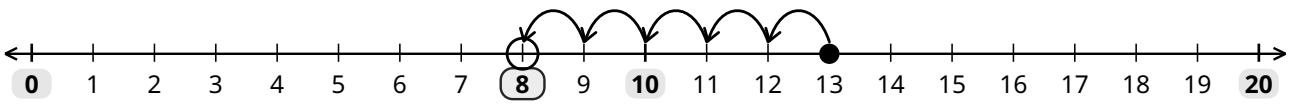

6 **20 − 7 =** **13**

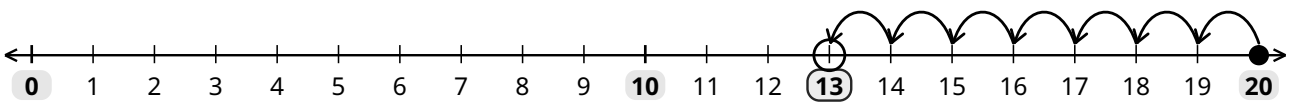

- Kiko’s tip: connect neighboring tick marks cleanly one step at a time without skipping any number.