Name : _____ Date : _____

PAPILUMO / 1st Grade (ages 6–7) • Answer key

Number Line Addition Within 20

Start on the black dot, draw forward hops to the right, and write the sum in the box.



"Ribbit! I'm Bibi the jumping frog. Help me hop forward along each number line to land on the right sum!"

Worked example: 8 + 5 = 13 (start at 8 and make 5 hops to the right)

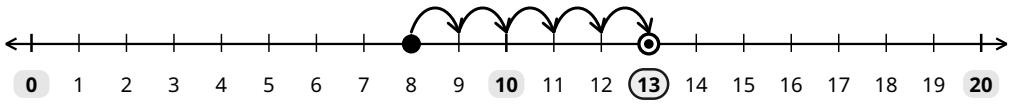

1. Draw the forward hops from the start dot and write each sum

1 **7 + 6 = 13**

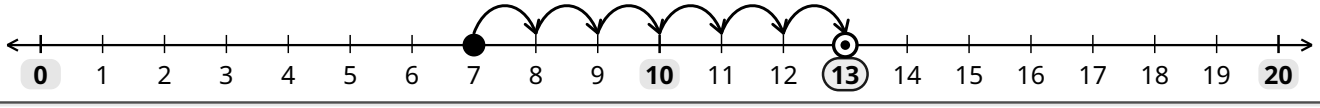

2 **9 + 5 = 14**

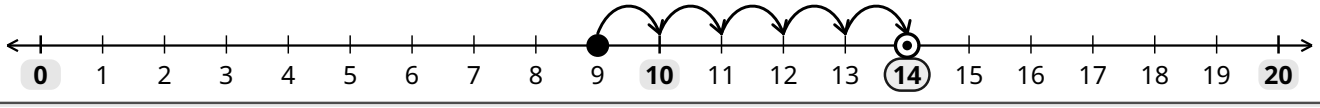

3 **6 + 8 = 14**

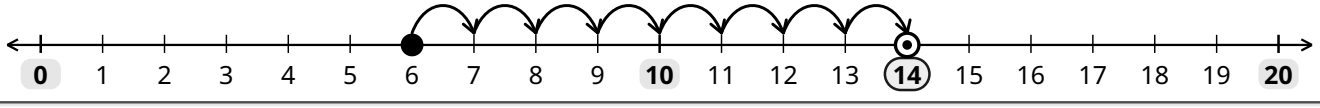

4 **11 + 7 = 18**

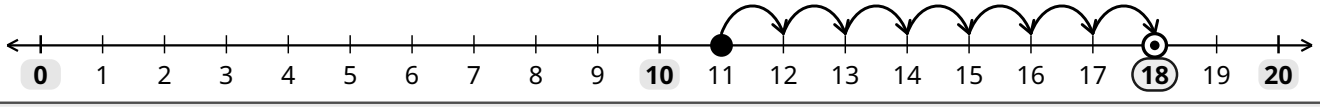

5 **8 + 9 = 17**

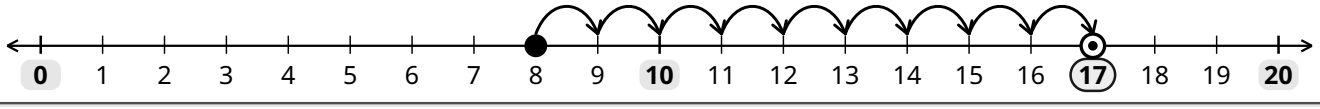

6 **12 + 6 = 18**

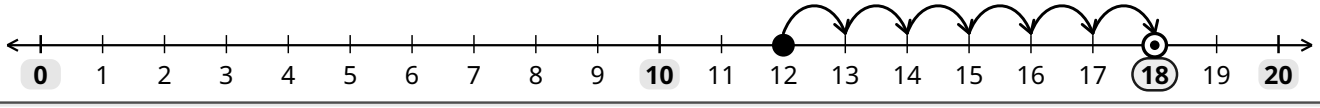

- Bibi's tip: the black dot shows where you start—count each hop as you land on the next tick mark to the right.