Name : _____ Date : _____

PAPILUMO | Grade 3 (ages 8–9)

# How Many Tens Are in a 3-Digit Number?

Look at the hundred flats and ten-bars, then write the total number of tens (and any leftover ones).




**Bennett the accountant beaver packs his timber by tens!**
**Help him count every ten, even inside each hundred.**

**Worked Example: 180 = 18 tens**



1 hundred (100) → 10 ten-bars + 8 ten-bars = 10 + 8 = 18 → 18 tens

**Watch out: the tens digit is 8, but there are 18 total tens in 180!**

## 1 Multiples of 10: how many total tens are in each number?

**1** 140 = _____ tens



**2** 230 = _____ tens



**3** 390 = _____ tens



**4** 500 = _____ tens



## 2 Numbers with leftover ones: write the total tens and remaining ones

**5** 245



= _____ tens and _____ ones

**6** 318



= _____ tens and _____ ones

**7** 407



= _____ tens and _____ ones

**8** 682



= _____ tens and _____ ones

Bennett's tip: every 100-flat is already made of 10 ten-bars. Count those first, then add the extra ten-bars!